ZiloAcademy

✨ Grade 1 Maths — 2D Shapes ✨

Name: Demo Grade 1 **Date:** 26/11/2026

Let's think it through together!

1



How many sides does this square have?

2



How many corners does this square have?

3



What is the name of this shape?

4. What 2D shape is a laptop screen shaped like?

5. What 2D shape is a book cover shaped like?

6. What 2D shape is a face of a Rubik's cube shaped like?

7. Which one is NOT a flat (2D) shape: circle, triangle, cone, square?

8. What 2D shape is an oval serving platter shaped like?

9. Which one is NOT a flat (2D) shape: diamond, circle, cube, oval?

10. 

How many sides does this triangle have?



You did it — great work!