ZiloAcademy

✨ Grade 1 Maths — Measurement & Geometry ✨

Name: Demo Grade 1 **Date:** 26/11/2026

Let's think it through together!

1



What is the name of this 3D shape?

2



A watermelon weighs 17 kg. A grape weighs 22 kg. Which is lighter?

3

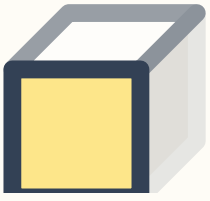

What is the name of this 3D shape?

4



How many sides does this square have?

5

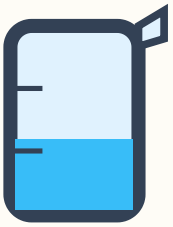

A bathtub holds 21 L of water. A cup holds 9 L of water. Which holds more?

6



What is the name of this shape?

7

What 3D shape is a can of soup?

8



What is the name of this 3D shape?

9

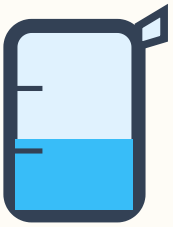

A bucket holds 9 L of water. A teaspoon holds 13 L of water. Which holds less?

10



A bag of rice weighs 16 kg. A bag of chips weighs 28 kg. Which is lighter?



You did it — great work!