ZiloAcademy

✨ Grade 2 Maths — 2D Shapes ✨

Name: Demo Grade 2 **Date:** 26/11/2026

Let's think it through together!

1

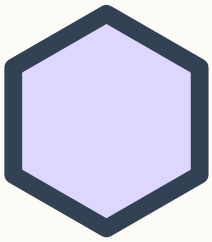

What is the name of this shape?

2



How many corners does this square have?

3

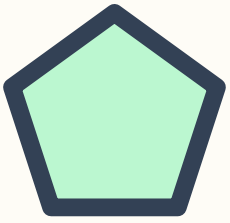

What is the name of this shape?

4. Which of these shapes has the fewest sides: triangle, diamond, square?

5. 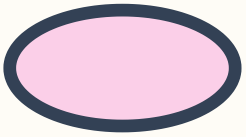

What is the name of this shape?

6. Which of these shapes has the fewest sides: square, oval, octagon?

7. 

How many lines of symmetry does this rectangle have?

8. 

What is the name of this shape?

9

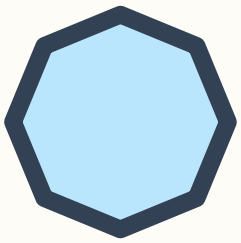

How many corners does this octagon have?

10

Which of these shapes has the most sides: circle, triangle, hexagon?



You did it — great work!