ZiloAcademy

✨ Grade 2 Maths — 3D Objects ✨

Name: Demo Grade 2 **Date:** 26/11/2026

Let's think it through together!

1



How many corners does a cuboid have?

2

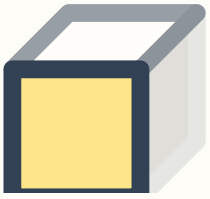

What is the name of this 3D shape?

3

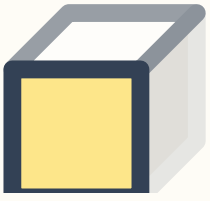

How many flat faces does a cube have?

4



How many flat faces does a sphere have?

5

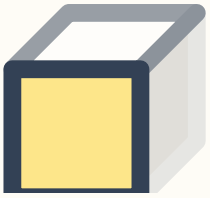

How many corners does a cube have?

6

What 3D shape is a Christmas tree, roughly, and what 3D shape is a test tube? (Separate your two answers with a comma.)

7



What is the name of this 3D shape?

8

What 3D shape is a Minecraft block?

9 What 3D shape is a toilet paper roll?

10 What 3D shape is a wedge of cheese?



You did it — great work!