ZiloAcademy

✨ Grade 2 Maths — Geometry ✨

Name: Demo Grade 2 **Date:** 26/11/2026

Let's think it through together!

1. A shape has 7 corners. What could it be called?

2. A shape has 6 corners. What could it be called?

3. A shape has 3 straight sides. What could it be called?

4. A shape has 5 corners. What could it be called?

5. 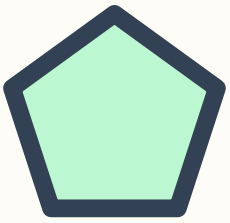

How many sides does a pentagon have?

6

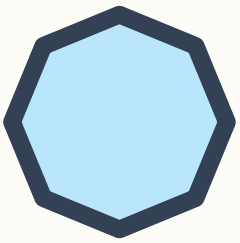

How many sides does a octagon have?

7

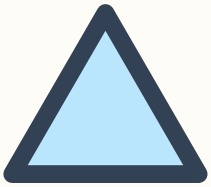

How many sides does a triangle have?

8

What shape is an open umbrella, seen from above shaped like, and what shape is a solar panel tile shaped like? (Separate your two answers with a comma.)

9

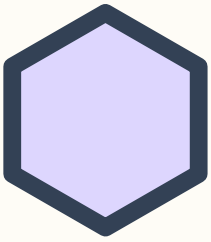

How many sides does a hexagon have?

10 One shape has 7 straight sides, and another has 3 straight sides. What could each be called? (Separate your two answers with a comma.)



You did it — great work!