ZiloAcademy

✨ Grade 2 Maths — Reading the Clock ✨

Name: Demo Grade 2 **Date:** 26/11/2026

Let's think it through together!

1



The clock shows the time now. What time will it be in 15 minutes?

2



The clock shows the time now. What time will it be in 15 minutes?

3



What time does the clock show?

4



The clock shows the time now. What time will it be in 10 minutes?

5



What time does the clock show?

6

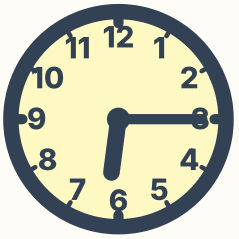

The clock shows the time now. What time will it be in 30 minutes?

7



The clock shows the time now. What time will it be in 30 minutes?

8



What time does the clock show?

9



What time does the clock show?

10

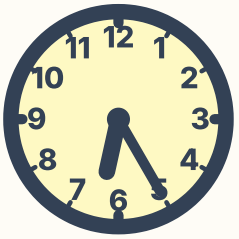

What time does the clock show?

You did it — great work!