ZiloAcademy

✨ Grade 3 Maths — Area Foundations ✨

Name: Demo Grade 3 **Date:** 26/11/2026

Let's think it through together!

1. 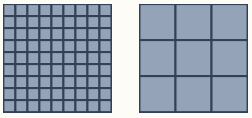

Rectangle A is 9 cm by 9 cm. Rectangle B is 3 cm by 3 cm. Which rectangle has the bigger area?

2. A rectangle is 6 cm by 3 cm. What is its area, in cm²?

3. A rectangle is 8 cm by 9 cm. What is its area, in cm²?

4. 

This grid is made of unit squares, 7 rows by 6 columns. How many unit squares are there in total?

5

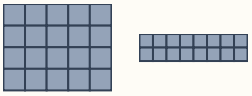

Rectangle A is 5 cm by 4 cm. Rectangle B is 8 cm by 2 cm. Which rectangle has the bigger area?

6

A rectangle is 7 cm by 6 cm. What is its area, in cm^2?

7

A rectangle is 9 cm by 5 cm. What is its area, in cm^2?

8

A rectangle has an area of **10** cm^2 and a width of **5** cm. What is its length, in cm?

9



This grid is made of unit squares, 4 rows by 8 columns. How many unit squares are there in total?

10

A square has sides 3 cm long. What is its area, in cm^2?



You did it — great work!