ZiloAcademy

✨ Grade 3 Maths — Chance & Probability ✨

Name: Demo Grade 3 **Date:** 26/11/2026

Let's think it through together!

1

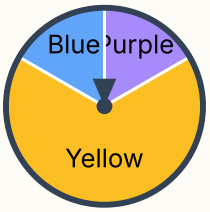

This spinner has 6 equal sections. Which colour is the spinner least likely to land on?

2

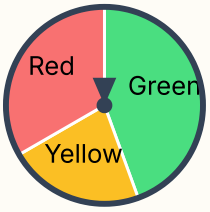

This spinner has 9 equal sections. What is the chance the spinner lands on Red? Write your answer as a fraction out of 9.

3

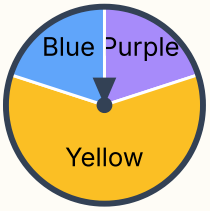

This spinner has 5 equal sections. What is the chance the spinner lands on Blue? Write your answer as a fraction out of 5.

4

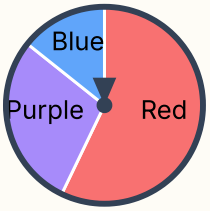

This spinner has 7 equal sections. Which colour is the spinner least likely to land on?

5

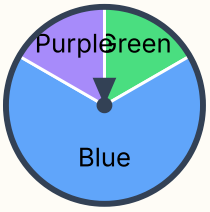

This spinner has 6 equal sections. Which colour is the spinner least likely to land on?

6

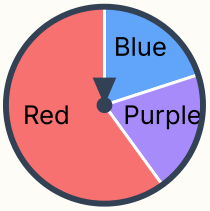

This spinner has 5 equal sections. Which colour is the spinner least likely to land on?

7



This spinner has 9 equal sections. Which colour is the spinner most likely to land on?

8

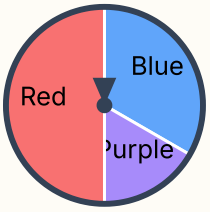

This spinner has 6 equal sections. Which colour is the spinner least likely to land on?

9



This spinner has 6 equal sections. Which colour is the spinner most likely to land on?

10

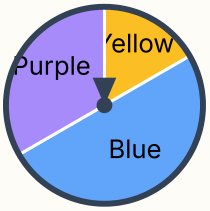

This spinner has 6 equal sections. What is the chance the spinner lands on Yellow? Write your answer as a fraction out of 6.

You did it — great work!