ZiloAcademy

# ✨ Grade 3 Maths — Money Skills ✨

**Name:** Demo Grade 3 **Date:** 26/11/2026

Let's think it through together!

1

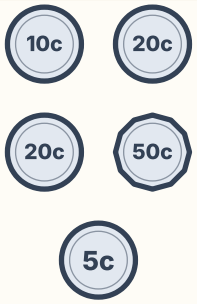


How much money is shown altogether?

2

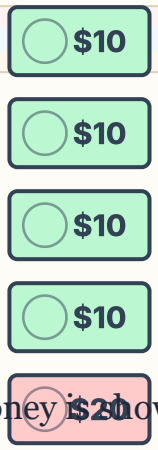


How much money is shown altogether?

3




How much money is shown altogether?

4




How much money is shown altogether?

5

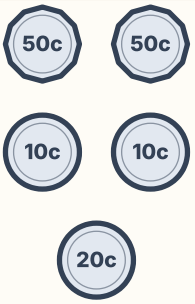


How much money is shown altogether?

6

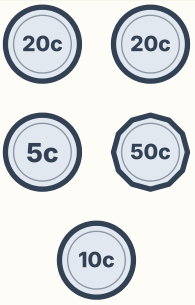


How much money is shown altogether?

7

A cap costs $2.48. You pay with $10. How much change do you get?

8

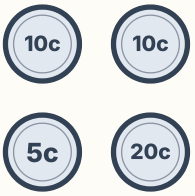


How much money is shown altogether?

9

An item costs 76 cents. You pay with a $1 coin (100 cents). How many cents change do you get?

10

An item costs 35 cents. You pay with a $1 coin (100 cents). How many cents change do you get?



You did it — great work!