ZiloAcademy

✨ Grade 3 Maths — Mass ✨

Name: Demo Grade 3 **Date:** 26/11/2026

Let's think it through together!

1. Crate A weighs 91 kg, Crate B weighs 67 kg, and Crate C weighs 25 kg. Which crate is heaviest?

2. How many kilograms is 14000 g?

3. A crate of apples weighs **96** kg. A crate of grapes weighs **46** kg. How much heavier is the crate of apples than the crate of grapes?

4. 

A suitcase weighs **15** kg in total. The balance scale shows it balances exactly against **3** equal bags. How much does each bag weigh, in kg?

5. A crate of apples weighs **33** kg. A crate of grapes weighs **81** kg. What is their total weight, in kg?

6. A fridge weighs **7** kg. A microwave weighs **81** kg. What is their total weight, in kg?

7. 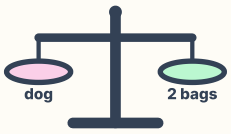

A dog weighs **12** kg in total. The balance scale shows it balances exactly against **2** equal bags. How much does each bag weigh, in kg?

8. 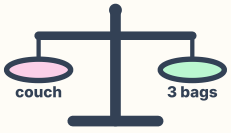

A couch weighs **9** kg in total. The balance scale shows it balances exactly against **3** equal bags. How much does each bag weigh, in kg?

9

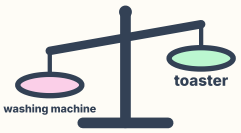

The balance scale shows the washing machine and the toaster. Which one is heavier?

10

How many grams is 17 kg?

You did it — great work!