ZiloAcademy

✨ Grade 3 Maths — Perimeter ✨

Name: Demo Grade 3 **Date:** 26/11/2026

Let's think it through together!

1. 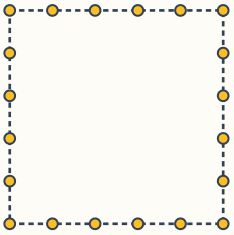

   Fence posts are placed every 2 m around this rectangular paddock, including one at each corner. How many fence posts are there in total?

   _____

2. A rectangle is 8 cm by 11 cm. What is its perimeter, in cm?

   _____

3. A rectangle is 16 cm by 24 cm. What is its perimeter, in cm?

   _____

4. A square has sides 7 cm long. What is its perimeter, in cm?

   _____

5. A rectangle is 11 cm by 9 cm. What is its perimeter, in cm?

   _____

6. A regular octagon has 8 equal sides, each 4 cm long. What is its perimeter, in cm?

7. 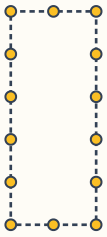

Fence posts are placed every 2 m around this rectangular paddock, including one at each corner. How many fence posts are there in total?

8. A triangle has sides 6 cm, 13 cm and 22 cm. What is its perimeter, in cm?

9. A rectangle is 20 cm by 17 cm. What is its perimeter, in cm?

10. 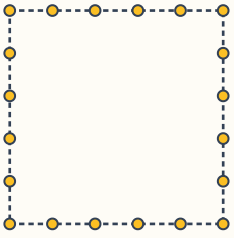

Fence posts are placed every 5 m around this rectangular paddock, including one at each corner. How many fence posts are there in total?



You did it — great work!