ZiloAcademy

✨ Grade 3 Maths — Position & Mapping ✨

Name: Demo Grade 3 **Date:** 26/11/2026

Let's think it through together!

1



Look at the grid. Which place is at grid reference C1?

2

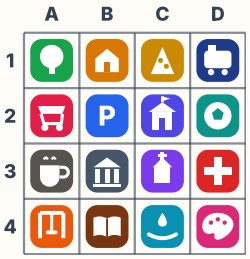

Look at the grid. The house's grid reference is written as a column letter followed by a row number (like "C4"). What is the grid reference for the house?

3

The bank is 5 blocks east and 5 blocks north of your home. Walking only along the streets (not diagonally), how many blocks would you walk to get there?

4

The cafe is 6 blocks east and 3 blocks north of your home. Walking only along the streets (not diagonally), how many blocks would you walk to get there?

5



Look at the grid. The fountain's grid reference is written as a column letter followed by a row number (like "C4"). What is the grid reference for the fountain?

6

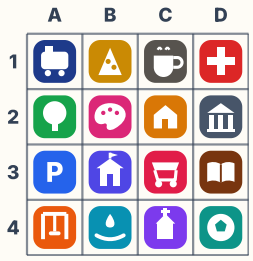

Look at the grid. The shop's grid reference is written as a column letter followed by a row number (like "C4"). What is the grid reference for the shop?

7



Look at the grid. The school's grid reference is written as a column letter followed by a row number (like "C4"). What is the grid reference for the school?

8

The park is **6** blocks east and **2** blocks north of your home. Walking only along the streets (not diagonally), how many blocks would you walk to get there?

9



Look at the grid. Which place is at grid reference C2?

10



Look at the grid. The house's grid reference is written as a column letter followed by a row number (like "C4"). What is the grid reference for the house?



You did it — great work!