ZiloAcademy

✨ Grade 3 Maths — Clocks & Calendars ✨

Name: Demo Grade 3 **Date:** 26/11/2026

Let's think it through together!

1

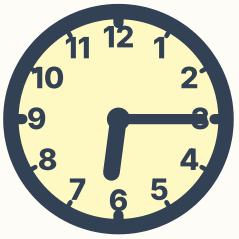

The clock shows the time now. What time will it be in 45 minutes?

2



The clock shows the time now. What time will it be in 20 minutes?

3

What day comes before Wednesday?

4



What time does the clock show?

5



What time does the clock show?

6

What day comes after Thursday?

7

How many days are in November (in a non-leap year)?

8

What day comes after Friday?

9



What time does the clock show?

10

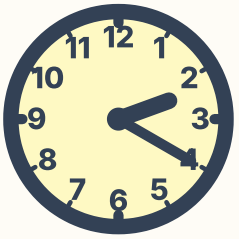

What time does the clock show?

You did it — great work!