ZiloAcademy

✨ Grade 4 Maths — Fractions on Number Lines ✨

Name: Demo Grade 4 **Date:** 26/11/2026

1



What fraction does the marked point show on this number line?

2

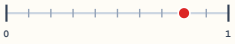

What fraction does the marked point show on this number line?

3

Which fraction is closer to 1: 1/5 or 7/8?

4



What fraction does the marked point show, written in its simplest form?

5



What fraction does the marked point show on this number line?

6



Is the marked point closer to 0 or to 1?

7



Is the marked point closer to 0 or to 1?

8



What fraction does the marked point show on this number line?

9



Is the marked point closer to 0 or to 1?

10

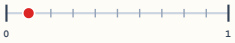

What fraction does the marked point show on this number line?