ZiloAcademy

✨ Grade 4 Maths — Symmetry ✨

Name: Demo Grade 4 **Date:** 26/11/2026

1



True or false: this diamond has 1 line of symmetry.

2

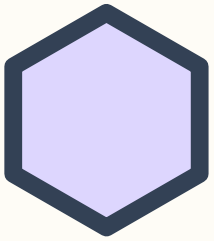

How many lines of symmetry does this hexagon have?

3

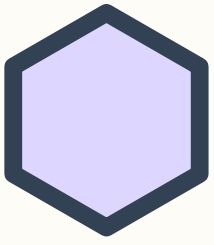

True or false: this hexagon has 6 lines of symmetry.

4



True or false: this square has 4 lines of symmetry.

5

Which of these shapes has the most lines of symmetry: diamond, triangle, square?

6

Which of these shapes has the fewest lines of symmetry: pentagon, hexagon, oval?

7

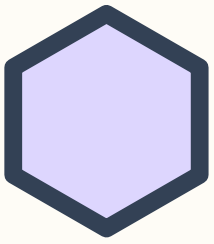

True or false: this hexagon has 1 line of symmetry.

8

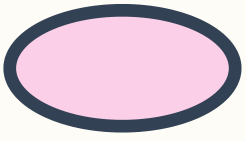

True or false: this oval has 2 lines of symmetry.

9

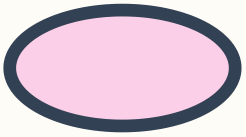

True or false: this oval has 3 lines of symmetry.

10

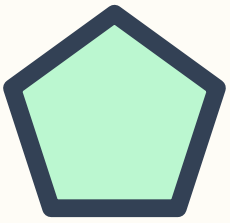

True or false: this pentagon has 3 lines of symmetry.