ZiloAcademy

✨ Grade 4 Maths — Time ✨

Name: Demo Grade 4 **Date:** 26/11/2026

1

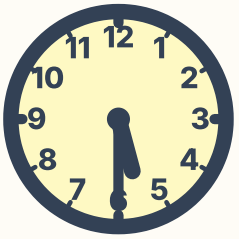

It is the afternoon/evening. The clock shows this time. Write it in 24-hour time:

_____

2

Write 05:15 in 12-hour time (with AM or PM):

_____

3



It is the morning. The clock shows this time. Write it in 24-hour time:

_____

4

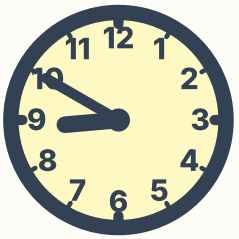

The clock shows when a movie starts. It runs for 125 minutes. What time does it finish?

5

Write 8:20 PM in 24-hour time:

6

Write 03:45 in 12-hour time (with AM or PM):

7

Write 12:50 AM in 24-hour time:

8



The clock shows when a movie starts. It runs for 23 minutes. What time does it finish?

9



The clock shows when a movie starts. It runs for 50 minutes. What time does it finish?

_____

10

Write 19:25 in 12-hour time (with AM or PM):

_____