ZiloAcademy

✨ Grade 5 Maths — Analysing Data ✨

Name: Demo Grade 5 **Date:** 26/11/2026

1

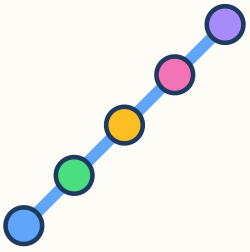

Over 5 days, money saved ($) went: 11, 18, 25, 32, 39. If the same pattern continues, what will it be on day 8?

2

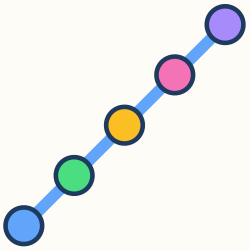

Over 5 days, steps walked (in hundreds) went: 6, 11, 16, 21, 26. If the same pattern continues, what will it be on day 8?

3

A puppy's weight (kg, ×10 for whole numbers) starts at 8 and increases by 11 each day. After how many days will it first reach 85?

4. A plant's height (cm) starts at 9 and increases by 8 each day. After how many days will it first reach 57?

5. Money saved ($) starts at 4 and increases by 10 each day. After how many days will it first reach 44?

6. 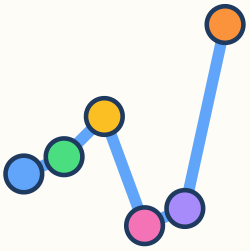

Over 6 days, a puppy's weight (kg, ×10 for whole numbers) was recorded as: 39, 42, 49, 30, 33, 65. On which day (1-6) was it lowest?

7. 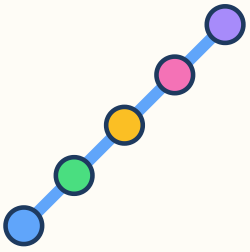

Over 5 days, a plant's height (cm) went: 13, 21, 29, 37, 45. If the same pattern continues, what will it be on day 8?

8

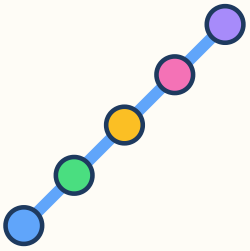

Over 5 days, steps walked (in hundreds) went: 7, 15, 23, 31, 39. If the same pattern continues, what will it be on day 8?

9

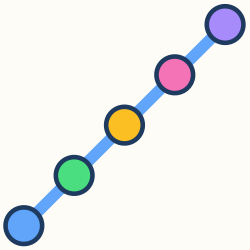

Over 5 days, money saved ($) went: 5, 12, 19, 26, 33. If the same pattern continues, what will it be on day 8?

10

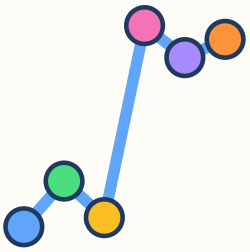

Over 6 days, a plant's height (cm) was recorded as: 20, 30, 22, 64, 57, 61. On which day (1-6) was it lowest?