ZiloAcademy

✨ Grade 5 Maths — Counting Money ✨

Name: Demo Grade 5 **Date:** 26/11/2026

1. 

How much money is shown altogether?

_____

2. 

How much money is shown altogether?

_____

3. An item costs $10.80. You pay with a $20 note. How much change do you get?

_____

4



How much money is shown altogether?

5



How much money is shown altogether?

6



How much money is shown altogether?

7

An item costs $3.28. You pay with a $5 note. How much change do you get?

8



How much money is shown altogether?

_____

9



How much money is shown altogether?

_____

10



How much money is shown altogether?

_____